张老师欧美留学理科辅导微信：15940415847

From the 2018 Administration

AP CollegeBoard

AP Physics 2: Algebra-Based

Practice Exam

NOTE: This is a modified version of the 2018 AP Physics 2: Algebra-Based Exam.

This exam may not be posted on school or personal websites, nor electronically redistributed for any reason. This Released Exam is provided by the College Board for AP Exam preparation. Teachers are permitted to download the materials and make copies to use with their students in a classroom setting only. To maintain the security of this exam, teachers should collect all materials after their administration and keep them in a secure location.

Further distribution of these materials outside of the secure College Board site disadvantages teachers who rely on uncirculated questions for classroom testing. Any additional distribution is in violation of the College Board's copyright policies and may result in the termination of Practice Exam access for your school as well as the removal of access to other online services such as the AP Teacher Community and Online Score Reports.

© 2018 The College Board. College Board, Advanced Placement Program, AP, AP Central, and the acorn logo are registered trademarks of the College Board. Visit the College Board on the Web: www.collegeboard.org.

AP Central is the official online home for the AP Program: apcentral.collegeboard.org

张老师欧美留学理科辅导微信：15940415847

Contents

Exam Instructions

Student Answer Sheet for the Multiple-Choice Section

Section I: Multiple-Choice Questions

Section II: Free-Response Questions

Multiple-Choice Answer Key

Free-Response Scoring Guidelines

Scoring Worksheet

Question Descriptors and Performance Data

Note: This publication shows the page numbers that appeared in the ***2017–18 AP Exam Instructions*** book and in the actual exam. This publication was not repaginated to begin with page 1.

© 2018 The College Board. College Board, Advanced Placement Program, AP, SAT and the acorn logo are registered trademarks of the College Board. All other products and services may be trademarks of their respective owners. Permission to use copyrighted College Board materials may be requested online at: www.collegeboard.org/request-form.

张老师欧美留学理科辅导微信：15940415847

Exam Instructions

The following contains instructions taken from the ***2017–18 AP Exam Instructions*** book.

张老师欧美留学理科辅导微信：15940415847

AP Physics 1: Algebra-Based Exam

Regularly Scheduled Exam Date: Tuesday afternoon, May 8, 2018
Late-Testing Exam Date: Thursday morning, May 24, 2018

AP Physics 2: Algebra-Based Exam

Regularly Scheduled Exam Date: Wednesday afternoon, May 9, 2018
Late-Testing Exam Date: Thursday afternoon, May 24, 2018

Section I	**Total Time:** 1 hour and 30 minutes Calculator allowed **Number of Questions:** 50 *(The number of questions may vary slightly depending on the form of the exam.)* **Percent of Total Score:** 50% **Writing Instrument:** Pencil required
Section II	**Total Time:** 1 hour and 30 minutes Calculator allowed **Number of Questions Physics 1:** 5 **Number of Questions Physics 2:** 4 **Percent of Total Score:** 50% **Writing Instrument:** Pen with black or dark blue ink, or pencil

What Proctors Need to Bring to This Exam

- ☐ Exam packets
- ☐ Answer sheets
- ☐ AP Student Packs
- ☐ *2017-18 AP Coordinator's Manual*
- ☐ This book—*2017-18 AP Exam Instructions*
- ☐ AP Exam Seating Chart template
- ☐ School Code and Homeschool/Self-Study Codes
- ☐ Extra calculators
- ☐ Extra rulers or straightedges
- ☐ Pencil sharpener
- ☐ Container for students' electronic devices (if needed)
- ☐ Extra No. 2 pencils with erasers
- ☐ Extra pens with black or dark blue ink
- ☐ Extra paper
- ☐ Stapler
- ☐ Watch
- ☐ Signs for the door to the testing room
  - "Exam in Progress"
  - "Cell phones are prohibited during the test administration, including breaks"

张老师欧美留学理科辅导微信：15940415847

Before Distributing Exams: Check that the title on all exam covers is ***Physics 1: Algebra-Based*** or ***Physics 2: Algebra-Based***. If there are any exam booklets with a different title, contact the AP coordinator immediately.

Students are permitted to use rulers, straightedges, and four-function, scientific, or graphing calculators for these entire exams (Sections I and II). Before starting the exam administration, make sure each student has an appropriate calculator, and any student with a graphing calculator has a model from the approved list on page 52 of the *2017-18 AP Coordinator's Manual*. See pages 49–52 of the *AP Coordinator's Manual* for more information. If a student does not have an appropriate calculator or has a graphing calculator not on the approved list, you may provide one from your supply. If the student does not want to use the calculator you provide or does not want to use a calculator at all, they must hand copy, date, and sign the release statement on page 51 of the *AP Coordinator's Manual*.

Students may have no more than two calculators on their desks. Calculators may not be shared. Calculator memories do not need to be cleared before or after the exam. Students with Hewlett-Packard 48–50 Series and Casio FX-9860 graphing calculators may use cards designed for use with these calculators. Proctors should make sure infrared ports (Hewlett-Packard) are not facing each other. **Since graphing calculators can be used to store data, including text, proctors should monitor that students are using their calculators appropriately. Attempts by students to use the calculator to remove exam questions and/or answers from the room may result in the cancellation of AP Exam scores.**

Tables containing equations commonly used in physics are included in each AP Exam booklet, for use during the entire exam. Students are NOT allowed to bring their own copies of the equation tables to the exam room.

SECTION I: Multiple Choice

› **Do not begin the exam instructions below until you have completed the appropriate General Instructions for your group.**

Make sure you begin the exam at the designated time. Remember, you must complete a seating chart for this exam. See pages 303–304 for a seating chart template and instructions. See the *2017-18 AP Coordinator's Manual* for exam seating requirements (pages 55–58).

Physics 1: Algebra-Based

If you are giving the regularly scheduled exam, say:
It is Tuesday afternoon, May 8, and you will be taking the AP Physics 1: Algebra-Based Exam.

If you are giving the alternate exam for late testing, say:
It is Thursday morning, May 24, and you will be taking the AP Physics 1: Algebra-Based Exam.

Physics 2: Algebra-Based

If you are giving the regularly scheduled exam, say:
It is Wednesday afternoon, May 9, and you will be taking the AP Physics 2: Algebra-Based Exam.

If you are giving the alternate exam for late testing, say:
It is Thursday afternoon, May 24, and you will be taking the AP Physics 2: Algebra-Based Exam.

张老师欧美留学理科辅导微信：15940415847

If you are giving the ***Physics 1: Algebra-Based Exam***, say:

Look at your exam packet and confirm that the exam title is "AP Physics 1: Algebra-Based." Raise your hand if your exam packet contains any title other than "AP Physics 1: Algebra-Based," and I will help you.

If you are giving the ***Physics 2: Algebra-Based Exam***, say:

Look at your exam packet and confirm that the exam title is "AP Physics 2: Algebra-Based." Raise your hand if your exam packet contains any title other than "AP Physics 2: Algebra-Based," and I will help you.

Once you confirm that all students have the correct exam, say:

In a moment, you will open the exam packet. By opening this packet, you agree to all of the AP Program's policies and procedures outlined in the *2017-18 Bulletin for AP Students and Parents*.

You may now remove the shrinkwrap from your exam packet and take out the Section I booklet, but do not open the booklet or the shrinkwrapped Section II materials. Put the white seals aside. . . .

Carefully remove the AP Exam label found near the top left of your exam booklet cover. Place it on page 1 of your answer sheet on the light blue box near the top right corner that reads "AP Exam Label."

If students accidentally place the exam label in the space for the number label or vice versa, advise them to leave the labels in place. They should not try to remove the label; their exam can still be processed correctly.

Listen carefully to all my instructions. I will give you time to complete each step. Please look up after completing each step. Raise your hand if you have any questions.

Give students enough time to complete each step. Don't move on until all students are ready.

Read the statements on the front cover of the Section I booklet. . . .

Sign your name and write today's date. . . .

Now print your full legal name where indicated. . . .

Turn to the back cover of your exam booklet and read it completely. . . .

Are there any questions? . . .

You will now take the multiple-choice portion of the exam. You should have in front of you the multiple-choice booklet and your answer sheet. You may never discuss the multiple-choice exam content at any time in any form with anyone, including your teacher and other students. If you disclose the multiple-choice exam content through any means, your AP Exam score will be canceled.

Open your answer sheet to page 2. You must complete the answer sheet using a No. 2 pencil only. Mark all of your responses on pages 2 and 3 of your answer sheet. Remember, for numbers 1 through 45 on answer sheet page 2, mark only the single best answer to each question. The answer sheet has circles marked A–E for each of these questions. For this exam, you will use only the circles marked A–D. For numbers 131 through 135 at the bottom of answer sheet page 3, mark the two best answer choices for each question. Completely fill in the circles. If you need to erase, do so carefully and completely. No credit will be given for anything written in the exam booklet. Scratch paper is not allowed, but you may use the margins or any blank space in the exam booklet for scratch work. Rulers, straightedges, and

张老师欧美留学理科辅导微信：15940415847

calculators may be used for the entire exam. You may place these items on your desk. Are there any questions? . . .

You have 1 hour and 30 minutes for this section. Open your Section I booklet and begin.

Note Start Time _____ . **Note Stop Time** _____ .

Check that students are marking their answers in pencil on their answer sheets and that they are not looking at their shrinkwrapped Section II booklets. You should also make sure that Hewlett-Packard calculators' infrared ports are not facing each other and that students are not sharing calculators.

After 1 hour and 20 minutes, say:

There are 10 minutes remaining.

After 10 minutes, say:

Stop working. Close your booklet and put your answer sheet on your desk, faceup. Make sure you have your AP number label and an AP Exam label on page 1 of your answer sheet. Sit quietly while I collect your answer sheets.

Collect an answer sheet from each student. Check that each answer sheet has an AP number label and an AP Exam label.

After all answer sheets have been collected, say:

Now you must seal your exam booklet using the white seals you set aside earlier. Remove the white seals from the backing and press one on each area of your exam booklet cover marked "PLACE SEAL HERE." Fold each seal over the back cover. When you have finished, place the booklet on your desk, faceup. I will now collect your Section I booklet. . . .

Collect a Section I booklet from each student. Check that each student has signed the front cover of the sealed Section I booklet.

There is a 10-minute break between Sections I and II. When all Section I materials have been collected and accounted for and you are ready for the break, say:

Please listen carefully to these instructions before we take a 10-minute break. Please put all of your calculators under your chair. Your calculators and all items you placed under your chair at the beginning of this exam must stay there, and you are not permitted to open or access them in any way. Leave your shrinkwrapped Section II packet on your desk during the break. You are not allowed to consult teachers, other students, notes, or textbooks during the break. You may not make phone calls, send text messages, check email, use a social networking site, or access any electronic or communication device. Remember, you may never discuss the multiple-choice exam content with anyone, and if you disclose the content through any means, your AP Exam score will be canceled. Are there any questions? . . .

You may begin your break. Testing will resume at _____ .

张老师欧美留学理科辅导微信：15940415847

SECTION II: Free Response

After the break, say:

May I have everyone's attention? Place your Student Pack on your desk. . . .

You may now remove the shrinkwrap from the Section II packet, but do not open the exam booklet until you are told to do so. . . .

Read the bulleted statements on the front cover of the exam booklet. Look up when you have finished. . . .

Now take an AP number label from your Student Pack and place it on the shaded box. If you don't have any AP number labels, write your AP number in the box. Look up when you have finished. . . .

Read the last statement. . . .

Using your pen, print the first, middle, and last initials of your legal name in the boxes and print today's date where indicated. This constitutes your signature and your agreement to the statements on the front cover. . . .

Turn to the back cover and, using your pen, complete Item 1 under "Important Identification Information." Print the first two letters of your last name and the first letter of your first name in the boxes. Look up when you have finished. . . .

In Item 2, print your date of birth in the boxes. . . .

In Item 3, write the school code you printed on the front of your Student Pack in the boxes. . . .

Read Item 4. . . .

Are there any questions? . . .

If this is your last AP Exam, you may keep your Student Pack. Place it under your chair for now. Otherwise I will collect all Student Packs. . . .

Read the information on the back cover of the exam booklet. Do not open the booklet until you are told to do so. Look up when you have finished. . . .

Collect the Student Packs.

Then say:

Are there any questions? . . .

Rulers, straightedges, and calculators may be used for Section II. Be sure these items are on your desk. . . .

You have 1 hour and 30 minutes to complete Section II. You are responsible for pacing yourself, and you may proceed freely from one question to the next.

If you are giving the *AP Physics 1: Algebra-Based Exam*, say:
Section II has 5 questions. It is suggested that you spend approximately 25 minutes each for questions 2 and 3, and 13 minutes each for questions 1, 4, and 5.

If you are giving the *AP Physics 2: Algebra-Based Exam*, say:
Section II has 4 questions. It is suggested that you spend approximately 25 minutes each for questions 2 and 3, and 20 minutes each for questions 1 and 4.

张老师欧美留学理科辅导微信：15940415847

You must write your answers in the exam booklet using a pen with black or dark blue ink or a No. 2 pencil. If you use a pencil, be sure that your writing is dark enough to be easily read. If you need more paper during the exam, raise your hand. At the top of each extra sheet of paper you use, write only your AP number and the question number you are working on. Do not write your name. Are there any questions? . . .

You may begin.

Note Start Time _____ . **Note Stop Time** _____ .

You should also make sure that Hewlett-Packard calculators' infrared ports are not facing each other and that students are not sharing calculators.

After 1 hour and 20 minutes, say:

There are 10 minutes remaining.

After 10 minutes, say:

Stop working and close your exam booklet. Place it on your desk, faceup. . . .

If any students used extra paper for a question in the free-response section, have those students staple the extra sheet(s) to the first page corresponding to that question in their exam booklets. Complete an Incident Report after the exam (see page 67 of the *2017-18 AP Coordinator's Manual* for complete details).

Then say:

Remain in your seat, without talking, while the exam materials are collected. . . .

Collect a Section II booklet from each student. Check for the following:

- Exam booklet front cover: The student placed an AP number label on the shaded box and printed their initials and today's date.
- Exam booklet back cover: The student completed the "Important Identification Information" area.

When all exam materials have been collected and accounted for, return to students any electronic devices you may have collected before the start of the exam.

If you are giving the regularly scheduled exam, say:
You may not discuss or share the free-response exam content with anyone unless it is released on the College Board website in about two days. Your AP Exam score results will be available online in July.

If you are giving the alternate exam for late testing, say:
None of the content in this exam may ever be discussed or shared in any way at any time. Your AP Exam score results will be available online in July.

If any students completed the AP number card at the beginning of this exam, say:

Please remember to take your AP number card with you. You will need the information on this card to view your scores and order AP score reporting services online.

Then say:

You are now dismissed.

张老师欧美留学理科辅导微信：15940415847

After-Exam Tasks

Be sure to give the completed seating chart to the AP coordinator. Schools must retain seating charts for at least six months (unless the state or district requires that they be retained for a longer period of time). Schools should not return any seating charts in their exam shipments unless they are required as part of an Incident Report.

NOTE: If you administered exams to students with accommodations, review the *2017-18 AP Coordinator's Manual* and the *2017-18 AP SSD Guidelines* for information about completing the NAR form, and returning these exams.

The exam proctor should complete the following tasks if asked to do so by the AP coordinator. Otherwise, the AP coordinator must complete these tasks:

- Complete an Incident Report for any students who used extra paper for the free-response section. (Incident Report forms are provided in the coordinator packets sent with the exam shipments.) **These forms must be completed with a No. 2 pencil.** It is best to complete a single Incident Report for multiple students per exam subject, per administration (regular or late testing), as long as all required information is provided. Include all exam booklets with extra sheets of paper in an Incident Report return envelope (see page 67 of the *2017-18 AP Coordinator's Manual* for complete details).
- Return all exam materials to secure storage until they are shipped back to the AP Program. (See page 26 of the *2017-18 AP Coordinator's Manual* for more information about secure storage.) Before storing materials, check the "School Use Only" section on page 1 of the answer sheet and:
  - Fill in the appropriate section number circle in order to access a separate AP Instructional Planning Report (for regularly scheduled exams only) or subject score roster at the class section or teacher level. See "Post-Exam Activities" in the *2017-18 AP Coordinator's Manual*.
  - Check your list of students who are eligible for fee reductions and fill in the appropriate circle on their registration answer sheets.

张老师欧美留学理科辅导微信：15940415847

Student Answer Sheet for the Multiple-Choice Section

Use this section to capture student responses. (Note that the following answer sheet is a sample, and may differ from one used in an actual exam.)

张老师欧美留学理科辅导微信：15940415847

CollegeBoard AP

Answer Sheet 2018

AP Number Label
(from Student Pack)

AP FPO X123456789 X

AP Exam Label
(from Section I Booklet)

COMPLETE THIS AREA AT EVERY EXAM. **USE NO. 2 PENCIL ONLY**

I am aware of and agree to follow the policies and procedures in the *2017-18 Bulletin for AP Students and Parents* to maintain the security of the exam and the validity of my AP score. I understand and accept that my exam score may be canceled if I do not follow these policies and procedures, if I disregard any exam day instructions, or if my exam is administered improperly. I certify that I am the person whose information appears on this answer sheet.

A. SIGNATURE Sign your legal name as it will appear on your college applications. Date

B. LEGAL NAME Omit apostrophes, Jr., II.

Legal Last Name — First 15 Letters | Legal First Name — First 12 Letters | MI

C. YOUR AP NUMBER

D. EXAM DATE Month Day

E. EXAM START TIME AM PM

F. MULTIPLE-CHOICE BOOKLET SERIAL NUMBER S

G. ONLINE PROVIDER CODE

COMPLETE THIS AREA ONLY ONCE.

I. AREA CODE AND PHONE NUMBER

INTERNATIONAL PHONE

J. SCHOOL YOU ATTEND

SCHOOL CODE | School Name | City | State | Country

K. DATE OF BIRTH

Month: Jan Feb Mar Apr May Jun Jul Aug Sep Oct Nov Dec

Day | Year

L. SOCIAL SECURITY NUMBER (Optional)

M. COLLEGE TO RECEIVE YOUR AP SCORE REPORT

COLLEGE CODE

Using the college code listed in the AP Student Pack, indicate the **ONE** college that you want to receive your AP score report.

College Name | City | State | Country

N. CURRENT GRADE LEVEL

- Not yet in 9th grade
- 9th
- 10th
- 11th
- 12th
- No longer in high school

O. STUDENT SEARCH SERVICE®

Colleges and scholarship programs may request your information to inform you of educational opportunities and financial aid.

Would you like us to supply your information?

- Yes
- No

If you don't answer and previously chose to participate in this service, we will continue providing your information.

H. AP EXAM I AM TAKING USING THIS ANSWER SHEET Exam Name: Form: Form Code:

801356

SCHOOL USE ONLY

Section Number: 1 2 3 4 5 6 7 8 9

Fee Reduction Granted: 1 Option 1 2 Option 2

121586-00657 • TF11017E5500 • Printed in U.S.A. Q4546/1-4

张老师欧美留学理科辅导微信：15940415847

COMPLETE THIS AREA AT EACH EXAM (IF APPLICABLE).

P. SURVEY QUESTIONS — Answer the survey questions in the AP Student Pack. Do not put responses to exam questions in this section.

1	A B C D E F G H I	4	A B C D E F G H I	7	A B C D E F G H I
2	A B C D E F G H I	5	A B C D E F G H I	8	A B C D E F G H I
3	A B C D E F G H I	6	A B C D E F G H I	9	A B C D E F G H I

Q. LANGUAGE — Do not complete this section unless instructed to do so.

If this answer sheet is for the French Language and Culture, German Language and Culture, Italian Language and Culture, Spanish Language and Culture, or Spanish Literature and Culture Exam, please answer the following questions. Your responses will not affect your score.

1. Have you lived or studied for one month or more in a country where the language of the exam you are now taking is spoken?

○ Yes ○ No

2. Do you regularly speak or hear the language at home?

○ Yes ○ No

QUESTIONS 1–75

Indicate your answers to the exam questions in this section (pages 2 and 3). Mark only one response per question for Questions 1 through 120. If a question has only four answer options, do not mark option E. Answers written in the multiple-choice booklet will not be scored.

COMPLETE MARK ● EXAMPLES OF INCOMPLETE MARKS 

You must use a No. 2 pencil and marks must be complete. Do not use a mechanical pencil. It is very important that you fill in the entire circle darkly and completely. If you change your response, erase as completely as possible. Incomplete marks or erasures may affect your score.

1	A B C D E	26	A B C D E	51	A B C D E
2	A B C D E	27	A B C D E	52	A B C D E
3	A B C D E	28	A B C D E	53	A B C D E
4	A B C D E	29	A B C D E	54	A B C D E
5	A B C D E	30	A B C D E	55	A B C D E
6	A B C D E	31	A B C D E	56	A B C D E
7	A B C D E	32	A B C D E	57	A B C D E
8	A B C D E	33	A B C D E	58	A B C D E
9	A B C D E	34	A B C D E	59	A B C D E
10	A B C D E	35	A B C D E	60	A B C D E
11	A B C D E	36	A B C D E	61	A B C D E
12	A B C D E	37	A B C D E	62	A B C D E
13	A B C D E	38	A B C D E	63	A B C D E
14	A B C D E	39	A B C D E	64	A B C D E
15	A B C D E	40	A B C D E	65	A B C D E
16	A B C D E	41	A B C D E	66	A B C D E
17	A B C D E	42	A B C D E	67	A B C D E
18	A B C D E	43	A B C D E	68	A B C D E
19	A B C D E	44	A B C D E	69	A B C D E
20	A B C D E	45	A B C D E	70	A B C D E
21	A B C D E	46	A B C D E	71	A B C D E
22	A B C D E	47	A B C D E	72	A B C D E
23	A B C D E	48	A B C D E	73	A B C D E
24	A B C D E	49	A B C D E	74	A B C D E
25	A B C D E	50	A B C D E	75	A B C D E

FOR OFFICIAL USE ONLY

Exam		0 1 2 3 4 5 6 7 8 9
		0 1 2 3 4 5 6 7 8 9
Exam		0 1 2 3 4 5 6 7 8 9
		0 1 2 3 4 5 6 7 8 9

SELECTED MEDIA EXAMS	R	W	O	OTHER EXAMS	R	W	O
PT02				TOTAL			
PT03				Subscore (if applicable)			
PT04				Subscore (if applicable)			

DO NOT WRITE IN THIS AREA

张老师欧美留学理科辅导微信：15940415847

QUESTIONS 76–120

Be sure each mark is dark and completely fills the circle. If a question has only four answer options, do not mark option E.

76	A B C D E	91	A B C D E	106	A B C D E
77	A B C D E	92	A B C D E	107	A B C D E
78	A B C D E	93	A B C D E	108	A B C D E
79	A B C D E	94	A B C D E	109	A B C D E
80	A B C D E	95	A B C D E	110	A B C D E
81	A B C D E	96	A B C D E	111	A B C D E
82	A B C D E	97	A B C D E	112	A B C D E
83	A B C D E	98	A B C D E	113	A B C D E
84	A B C D E	99	A B C D E	114	A B C D E
85	A B C D E	100	A B C D E	115	A B C D E
86	A B C D E	101	A B C D E	116	A B C D E
87	A B C D E	102	A B C D E	117	A B C D E
88	A B C D E	103	A B C D E	118	A B C D E
89	A B C D E	104	A B C D E	119	A B C D E
90	A B C D E	105	A B C D E	120	A B C D E

QUESTIONS 121–126

For Students Taking AP Biology

Write your answer in the boxes at the top of the griddable area and fill in the corresponding circles. Mark only one circle in any column. You will receive credit only if the circles are filled in correctly.

121 122 123 124 125 126

QUESTIONS 131–142

For Students Taking AP Computer Science Principles, AP Physics 1, or AP Physics 2

Mark two responses per question. You will receive credit only if both correct responses are selected.

131	A B C D	135	A B C D	139	A B C D
132	A B C D	136	A B C D	140	A B C D
133	A B C D	137	A B C D	141	A B C D
134	A B C D	138	A B C D	142	A B C D

© 2017 The College Board. College Board, AP, Student Search Service and the acorn logo are registered trademarks of the College Board.

DO NOT WRITE IN THIS AREA

张老师欧美留学理科辅导微信：15940415847

COMPLETE THIS AREA ONLY ONCE.

R. YOUR MAILING ADDRESS Use the address abbreviations from your AP Student Pack. Fill in only one circle per column. Indicate a space in your address by leaving a blank box; do not grid that column.

STREET ADDRESS (include street number, street name, apartment number, etc.)

CITY

ZIP OR POSTAL CODE

COUNTRY CODE

STATE

AK	HI	MI	NY	VT	
AL	IA	MN	OH	WA	
AR	ID	MS	OR	WV	
AZ	IL	MT	PA	WY	
CA	IN	NC	RI	Puerto Rico	
CO	KS	ND	SC		
CT	KY	NE	SD	AA	
DC	LA	NH	TN	AE	
DE	MA	NJ	TX	AP	
FL	MD	NM	UT	Other	
GA	ME	NV	VA		

V. SEX

- Female
- Male

W. WHICH LANGUAGE DO YOU KNOW BEST?

- English
- English and another language about the same
- Another language

X. RACIAL/ETHNIC GROUP

Please answer both questions about Hispanic origin and about race. For the following questions about your identity, Hispanic origins are not races.

(You may mark all that apply.)

a. Are you of Hispanic, Latino, or Spanish origin?

- No, not of Hispanic, Latino, or Spanish origin
- Yes, Cuban
- Yes, Mexican
- Yes, Puerto Rican
- Yes, another Hispanic, Latino, or Spanish origin

b. What is your race?

- American Indian or Alaska Native
- Asian (including Indian subcontinent and Philippines origin)
- Black or African American (including Africa and Afro-Caribbean origin)
- Native Hawaiian or other Pacific Islander
- White (including Middle Eastern origin)

Y. PARENTAL EDUCATION LEVEL

In the first column, indicate the highest level of education of one parent/guardian, and indicate whether this is your mother/female guardian or father/male guardian. Then, if applicable, indicate the highest level of education of your other parent/guardian in the second column, and indicate whether this is your mother/female guardian or father/male guardian.

Mother or female guardian	
Father or male guardian	
Grade school	
Some high school	
High school diploma or equivalent	
Vocational or trade school	
Some college	
Associate or two-year degree	
Bachelor's or four-year degree	
Some graduate or professional school	
Graduate or professional degree	

S. FOR STUDENTS OUTSIDE THE UNITED STATES ONLY If your address does not fit in the spaces provided in Item R, fill in as many circles as you can, then fill in the circle in Item S and print the remainder of your address in the spaces provided.

T. STUDENT IDENTIFIER (Student ID Number)

Address	City	State or Province	Country	ZIP or Postal Code

U. EMAIL ADDRESS By providing your email address, you are granting the College Board permission to use your email address in accordance with the policies in the *2017-18 Bulletin for AP Students and Parents*.

张老师欧美留学理科辅导微信：15940415847

Section I: Multiple-Choice Questions

This is the multiple-choice section of the 2018 AP Exam.
It includes cover material and other administrative instructions
to help familiarize students with the mechanics of the exam.
(Note that future exams may differ in look from the following content.)

For purposes of test security and/or statistical analysis, some questions
have been removed from the version of the exam that was administered
in 2018. Therefore, the timing indicated here may not be appropriate
for a practice exam.

张老师欧美留学理科辅导微信：15940415847

AP® Physics 2: Algebra-Based Exam

SECTION I: Multiple Choice

2018

DO NOT OPEN THIS BOOKLET UNTIL YOU ARE TOLD TO DO SO.

At a Glance

Total Time
1 hour and 30 minutes
Number of Questions
40
Percent of Total Score
50%
Writing Instrument
Pencil required
Electronic Device
Calculator allowed

Instructions

Section I of this exam contains 40 multiple-choice questions. Pages containing equations and other information are also printed in this booklet. Calculators, rulers, and straightedges may be used in this section.

Indicate all of your answers to the multiple-choice questions on the answer sheet. No credit will be given for anything written in this exam booklet, but you may use the booklet for notes or scratch work.

Because this section offers only four answer options for each question, do not mark the (E) answer circle for any question. If you change an answer, be sure that the previous mark is erased completely.

For questions 1 through 36, select the single best answer choice for each question. After you have decided which of the choices is best, completely fill in the corresponding circle on the answer sheet. Here is a sample question and answer.

Sample Question	Sample Answer
Chicago is a (A) state (B) city (C) country (D) continent	Ⓐ ● Ⓒ Ⓓ Ⓔ

For questions 131 through 134, select the two best answer choices for each question. After you have decided which two choices are best, completely fill in the two corresponding circles on the answer sheet. Here is a sample question and answer.

Sample Question	Sample Answer
New York is a (A) state (B) city (C) country (D) continent	● ● Ⓒ Ⓓ

Use your time effectively, working as quickly as you can without losing accuracy. Do not spend too much time on any one question. Go on to other questions and come back to the ones you have not answered if you have time. It is not expected that everyone will know the answers to all of the multiple-choice questions.

Your total score on Section I is based only on the number of questions answered correctly. Points are not deducted for incorrect answers or unanswered questions.

Form I
Form Code 4OBP4-S

84

张老师欧美留学理科辅导微信：15940415847

AP® PHYSICS 2 TABLE OF INFORMATION

CONSTANTS AND CONVERSION FACTORS	
Proton mass, $m_p = 1.67 \times 10^{-27}$ kg	Electron charge magnitude, $e = 1.60 \times 10^{-19}$ C
Neutron mass, $m_n = 1.67 \times 10^{-27}$ kg	1 electron volt, $1 \text{ eV} = 1.60 \times 10^{-19}$ J
Electron mass, $m_e = 9.11 \times 10^{-31}$ kg	Speed of light, $c = 3.00 \times 10^{8}$ m/s
Avogadro's number, $N_0 = 6.02 \times 10^{23}$ mol^{-1}	Universal gravitational constant, $G = 6.67 \times 10^{-11}$ m^3/kg·s^2
Universal gas constant, $R = 8.31$ J/(mol·K)	Acceleration due to gravity at Earth's surface, $g = 9.8$ m/s^2
Boltzmann's constant, $k_B = 1.38 \times 10^{-23}$ J/K	

1 unified atomic mass unit,	$1 \text{ u} = 1.66 \times 10^{-27}$ kg $= 931$ MeV/c^2
Planck's constant,	$h = 6.63 \times 10^{-34}$ J·s $= 4.14 \times 10^{-15}$ eV·s
	$hc = 1.99 \times 10^{-25}$ J·m $= 1.24 \times 10^{3}$ eV·nm
Vacuum permittivity,	$\varepsilon_0 = 8.85 \times 10^{-12}$ C^2/N·m^2
Coulomb's law constant,	$k = 1/4\pi\varepsilon_0 = 9.0 \times 10^{9}$ N·m^2/C^2
Vacuum permeability,	$\mu_0 = 4\pi \times 10^{-7}$ (T·m)/A
Magnetic constant,	$k' = \mu_0/4\pi = 1 \times 10^{-7}$ (T·m)/A
1 atmosphere pressure,	$1 \text{ atm} = 1.0 \times 10^{5}$ N/m^2 $= 1.0 \times 10^{5}$ Pa

UNIT SYMBOLS	meter,	m	mole,	mol	watt,	W	farad,	F
	kilogram,	kg	hertz,	Hz	coulomb,	C	tesla,	T
	second,	s	newton,	N	volt,	V	degree Celsius,	°C
	ampere,	A	pascal,	Pa	ohm,	Ω	electron volt,	eV
	kelvin,	K	joule,	J	henry,	H		

PREFIXES		
Factor	Prefix	Symbol
10^{12}	tera	T
10^{9}	giga	G
10^{6}	mega	M
10^{3}	kilo	k
10^{-2}	centi	c
10^{-3}	milli	m
10^{-6}	micro	μ
10^{-9}	nano	n
10^{-12}	pico	p

VALUES OF TRIGONOMETRIC FUNCTIONS FOR COMMON ANGLES							
θ	0°	30°	37°	45°	53°	60°	90°
$\sin\theta$	0	1/2	3/5	$\sqrt{2}/2$	4/5	$\sqrt{3}/2$	1
$\cos\theta$	1	$\sqrt{3}/2$	4/5	$\sqrt{2}/2$	3/5	1/2	0
$\tan\theta$	0	$\sqrt{3}/3$	3/4	1	4/3	$\sqrt{3}$	∞

The following conventions are used in this exam.

I. The frame of reference of any problem is assumed to be inertial unless otherwise stated.
II. In all situations, positive work is defined as work done on a system.
III. The direction of current is conventional current: the direction in which positive charge would drift.
IV. Assume all batteries and meters are ideal unless otherwise stated.
V. Assume edge effects for the electric field of a parallel plate capacitor unless otherwise stated.
VI. For any isolated electrically charged object, the electric potential is defined as zero at infinite distance from the charged object

张老师欧美留学理科辅导微信：15940415847

AP® PHYSICS 2 EQUATIONS

MECHANICS

$v_x = v_{x0} + a_x t$

$x = x_0 + v_{x0}t + \frac{1}{2}a_x t^2$

$v_x^2 = v_{x0}^2 + 2a_x(x - x_0)$

$\vec{a} = \frac{\sum \vec{F}}{m} = \frac{\vec{F}_{net}}{m}$

$|\vec{F}_f| \le \mu |\vec{F}_n|$

$a_c = \frac{v^2}{r}$

$\vec{p} = m\vec{v}$

$\Delta\vec{p} = \vec{F}\,\Delta t$

$K = \frac{1}{2}mv^2$

$\Delta E = W = F_{\|}d = Fd\cos\theta$

$P = \frac{\Delta E}{\Delta t}$

$\theta = \theta_0 + \omega_0 t + \frac{1}{2}\alpha t^2$

$\omega = \omega_0 + \alpha t$

$x = A\cos(\omega t) = A\cos(2\pi f t)$

$x_{cm} = \frac{\sum m_i x_i}{\sum m_i}$

$\vec{\alpha} = \frac{\sum \vec{\tau}}{I} = \frac{\vec{\tau}_{net}}{I}$

$\tau = r_{\perp}F = rF\sin\theta$

$L = I\omega$

$\Delta L = \tau\,\Delta t$

$K = \frac{1}{2}I\omega^2$

$|\vec{F}_s| = k|\vec{x}|$

a = acceleration
A = amplitude
d = distance
E = energy
F = force
f = frequency
I = rotational inertia
K = kinetic energy
k = spring constant
L = angular momentum
ℓ = length
m = mass
P = power
p = momentum
r = radius or separation
T = period
t = time
U = potential energy
v = speed
W = work done on a system
x = position
y = height
α = angular acceleration
μ = coefficient of friction
θ = angle
τ = torque
ω = angular speed

$U_s = \frac{1}{2}kx^2$

$\Delta U_g = mg\,\Delta y$

$T = \frac{2\pi}{\omega} = \frac{1}{f}$

$T_s = 2\pi\sqrt{\frac{m}{k}}$

$T_p = 2\pi\sqrt{\frac{\ell}{g}}$

$|\vec{F}_g| = G\frac{m_1 m_2}{r^2}$

$\vec{g} = \frac{\vec{F}_g}{m}$

$U_G = -\frac{Gm_1 m_2}{r}$

ELECTRICITY AND MAGNETISM

$|\vec{F}_E| = \frac{1}{4\pi\varepsilon_0}\frac{|q_1 q_2|}{r^2}$

$\vec{E} = \frac{\vec{F}_E}{q}$

$|\vec{E}| = \frac{1}{4\pi\varepsilon_0}\frac{|q|}{r^2}$

$\Delta U_E = q\Delta V$

$V = \frac{1}{4\pi\varepsilon_0}\frac{q}{r}$

$|\vec{E}| = \left|\frac{\Delta V}{\Delta r}\right|$

$\Delta V = \frac{Q}{C}$

$C = \kappa\varepsilon_0\frac{A}{d}$

$E = \frac{Q}{\varepsilon_0 A}$

$U_C = \frac{1}{2}Q\Delta V = \frac{1}{2}C(\Delta V)^2$

$I = \frac{\Delta Q}{\Delta t}$

$R = \frac{\rho\ell}{A}$

$P = I\,\Delta V$

$I = \frac{\Delta V}{R}$

$R_s = \sum_i R_i$

$\frac{1}{R_p} = \sum_i \frac{1}{R_i}$

$C_p = \sum_i C_i$

$\frac{1}{C_s} = \sum_i \frac{1}{C_i}$

$B = \frac{\mu_0}{2\pi}\frac{I}{r}$

A = area
B = magnetic field
C = capacitance
d = distance
E = electric field
$\mathcal{E}$ = emf
F = force
I = current
ℓ = length
P = power
Q = charge
q = point charge
R = resistance
r = separation
t = time
U = potential (stored) energy
V = electric potential
v = speed
κ = dielectric constant
ρ = resistivity
θ = angle
Φ = flux

$\vec{F}_M = q\vec{v}\times\vec{B}$

$|\vec{F}_M| = |q\vec{v}||\sin\theta||\vec{B}|$

$\vec{F}_M = I\vec{\ell}\times\vec{B}$

$|\vec{F}_M| = |I\vec{\ell}||\sin\theta||\vec{B}|$

$\Phi_B = \vec{B}\cdot\vec{A}$

$\Phi_B = |\vec{B}|\cos\theta|\vec{A}|$

$\mathcal{E} = -\frac{\Delta\Phi_B}{\Delta t}$

$\mathcal{E} = B\ell v$

张老师欧美留学理科辅导微信：15940415847

AP® PHYSICS 2 EQUATIONS

FLUID MECHANICS AND THERMAL PHYSICS

$\rho = \frac{m}{V}$

$P = \frac{F}{A}$

$P = P_0 + \rho g h$

$F_b = \rho V g$

$A_1 v_1 = A_2 v_2$

$P_1 + \rho g y_1 + \frac{1}{2}\rho {v_1}^2 = P_2 + \rho g y_2 + \frac{1}{2}\rho {v_2}^2$

$\frac{Q}{\Delta t} = \frac{kA\,\Delta T}{L}$

$PV = nRT = Nk_BT$

$K = \frac{3}{2}k_BT$

$W = -P\Delta V$

$\Delta U = Q + W$

A = area
F = force
h = depth
k = thermal conductivity
K = kinetic energy
L = thickness
m = mass
n = number of moles
N = number of molecules
P = pressure
Q = energy transferred to a system by heating
T = temperature
t = time
U = internal energy
V = volume
v = speed
W = work done on a system
y = height
ρ = density

MODERN PHYSICS

$E = hf$

$K_{\max} = hf - \phi$

$\lambda = \frac{h}{p}$

$E = mc^2$

E = energy
f = frequency
K = kinetic energy
m = mass
p = momentum
λ = wavelength
ϕ = work function

WAVES AND OPTICS

$\lambda = \frac{v}{f}$

$n = \frac{c}{v}$

$n_1 \sin\theta_1 = n_2 \sin\theta_2$

$\frac{1}{s_i} + \frac{1}{s_o} = \frac{1}{f}$

$|M| = \left|\frac{h_i}{h_o}\right| = \left|\frac{s_i}{s_o}\right|$

$\Delta L = m\lambda$

$d\sin\theta = m\lambda$

d = separation
f = frequency or focal length
h = height
L = distance
M = magnification
m = an integer
n = index of refraction
s = distance
v = speed
λ = wavelength
θ = angle

GEOMETRY AND TRIGONOMETRY

Rectangle
$A = bh$

Triangle
$A = \frac{1}{2}bh$

Circle
$A = \pi r^2$
$C = 2\pi r$

Rectangular solid
$V = \ell w h$

Cylinder
$V = \pi r^2 \ell$
$S = 2\pi r\ell + 2\pi r^2$

Sphere
$V = \frac{4}{3}\pi r^3$
$S = 4\pi r^2$

A = area
C = circumference
V = volume
S = surface area
b = base
h = height
ℓ = length
w = width
r = radius

Right triangle
$c^2 = a^2 + b^2$
$\sin\theta = \frac{a}{c}$
$\cos\theta = \frac{b}{c}$
$\tan\theta = \frac{a}{b}$

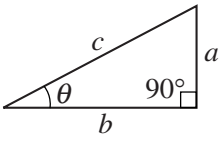

张老师欧美留学理科辅导微信：15940415847

PHYSICS 2

Section I

Time—1 hour and 30 minutes

50 Questions

Note: To simplify calculations, you may use $g = 10\ \text{m/s}^2$ in all problems.

Directions: Each of the questions or incomplete statements below is followed by four suggested answers or completions. Select the one that is best in each case and then fill in the corresponding circle on the answer sheet.

1. Two waves are created in air and move toward outer space. Wave X cannot travel in the vacuum of outer space, but wave Y can. What types of waves are X and Y?

	Wave X	Wave Y
(A)	Electromagnetic	Mechanical
(B)	Electromagnetic	Electromagnetic
(C)	Mechanical	Mechanical
(D)	Mechanical	Electromagnetic

Unauthorized copying or reuse of any part of this page is illegal.

GO ON TO THE NEXT PAGE.

张老师欧美留学理科辅导微信：15940415847

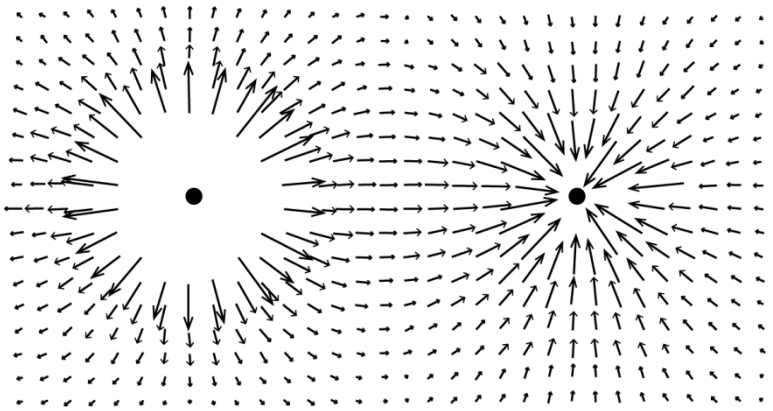

2. Which of the following is a correct description of the field diagram shown above?

   (A) It shows field vectors for two particles with charges of opposite sign and about the same magnitude, and it could also represent their gravitational field if they have about the same mass.
   (B) It shows field vectors for two particles with charges of opposite sign and about the same magnitude, but it could not represent their gravitational field.
   (C) It shows field vectors for two particles with charges of the same sign and about the same magnitude, and it could also represent their gravitational field if they have about the same mass.
   (D) It shows field vectors for two particles with charges of the same sign and about the same magnitude, but it could not represent their gravitational field.

Unauthorized copying or reuse of any part of this page is illegal.

GO ON TO THE NEXT PAGE.

张老师欧美留学理科辅导微信：15940415847

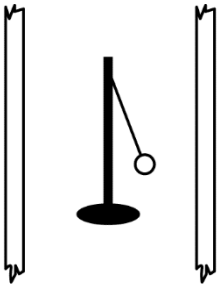

Note: Figure not drawn to scale.

3. Some students are trying to determine whether the radius of a metal sphere affects the amount of charge that it can hold. The students have metal spheres of different radii and known masses that can be attached to a stand by a string, as shown above. The stand is midway between a set of large plates that are connected to a battery to create a nearly uniform electric field in the region between them and near their centers. The students rub a rod with cloth and touch it to each sphere to charge the sphere, and they observe the deflection of the sphere as it is attracted to one plate. They keep adding charge to each sphere until they cannot observe any change in deflection. Which of the following data will give them information that is useful for quantitatively comparing the amount of charge on each sphere?

(A) The number of times they rub the cloth back and forth on the rod
(B) The number of times they touch the rod to the sphere
(C) The string's angle of deflection
(D) The string's direction of deflection

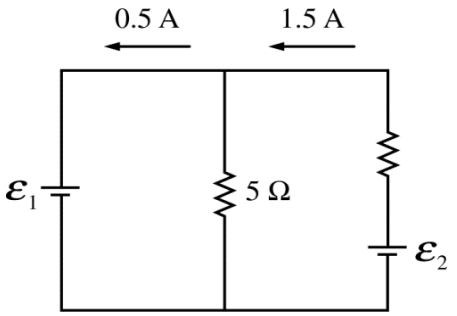

4. What are the value and the direction of the current through the 5 Ω resistor in the circuit shown above?

(A) 1.0 A toward the top of the page
(B) 1.0 A toward the bottom of the page
(C) 2.0 A toward the top of the page
(D) 2.0 A toward the bottom of the page

Unauthorized copying or reuse of any part of this page is illegal.

GO ON TO THE NEXT PAGE.

张老师欧美留学理科辅导微信：15940415847

Questions 5-7 refer to the following material.

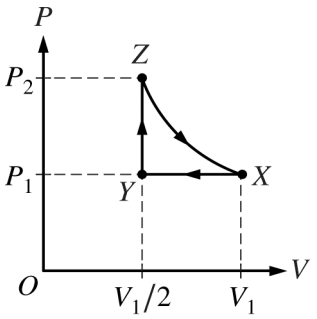

A closed chamber filled with a gas that is modeled as ideal has a movable piston of area A. The graph above of pressure P as a function of volume V shows three processes that make up cycle $XYZX$ through which the gas is taken. Process ZX is isothermal.

5. During which process is no work done on or by the gas?

   (A) XY
   (B) YZ
   (C) ZX
   (D) Work was done on or by the gas during every process.

6. What is the force exerted on the piston by the gas during process XY ?

   (A) P_1V_1
   (B) $P_1V_1/2$
   (C) P_1A
   (D) $P_1A/2$

7. During which process is the amount of work done on the gas equal to the amount of energy that the gas exchanges with its surroundings through heating or cooling?

   (A) XY
   (B) YZ
   (C) ZX
   (D) None of the processes; the amount of work done on the gas is always greater than the amount of energy that the gas exchanges with its surroundings through heating or cooling.

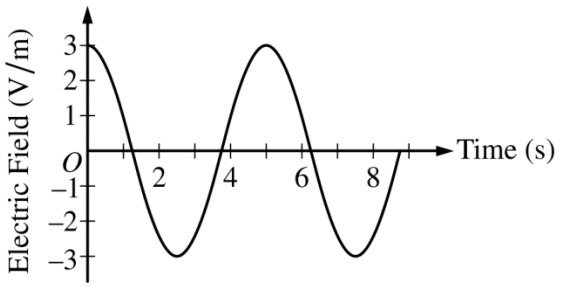

8. The graph above represents the magnitude E of the electric field at a point in space as a function of time t. Which of the following is a correct equation for the field if E is in V/m and t is in s?

   (A) $E = 3\cos(2\pi t/5)$
   (B) $E = 3\cos(2\pi t/3)$
   (C) $E = 5\cos(2\pi t/5)$
   (D) $E = 5\cos(2\pi t/3)$

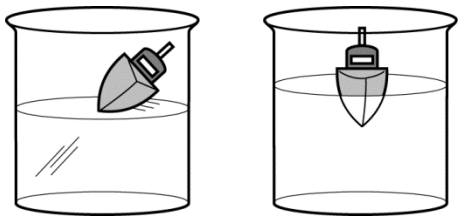

9. A toy boat sits atop a cylinder of ice in a beaker, as shown above on the left. A normal force is exerted on the boat by the surface of the ice. Later the ice has melted, and the boat floats while partially submerged in the water, as shown on the right. A buoyant force is exerted on the boat by the water. Which of the forces, if either, is greater and why?

   (A) The normal force is greater because molecules in solids exert larger interatomic forces on other objects than molecules in liquids do.
   (B) The buoyant force is greater because more molecules of water are in contact with the boat, so the net interatomic force between the water and the boat is greater.
   (C) The forces are equal because each molecule of ice in contact with the boat exerts the same interatomic force on the boat as each molecule of water in contact with the boat.
   (D) The forces are equal because in both cases the net interatomic force exerted by the ice or water on the boat and the gravitational force on the boat balance.

Unauthorized copying or reuse of any part of this page is illegal.

GO ON TO THE NEXT PAGE.

张老师欧美留学理科辅导微信：15940415847

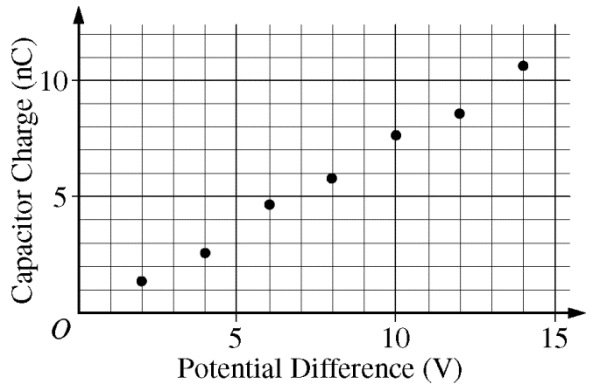

Graph 1: Capacitor with Air

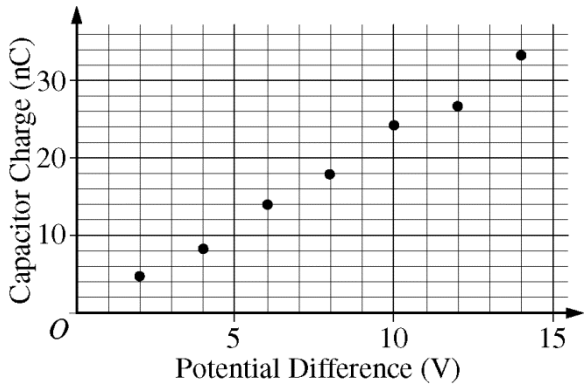

Graph 2: Capacitor with Dielectric

10. A capacitor initially has only air between its plates. The charge on the capacitor as a function of applied potential difference is measured, and the results are shown in graph 1 above. The capacitor is discharged, a dielectric material is inserted between the plates, and the charge as a function of applied potential difference is measured again. The results are shown in graph 2. Which of the following is equal to the dielectric constant of the material inserted into the capacitor?

(A) The slope of graph 1 divided by the slope of graph 2
(B) The slope of graph 2 divided by the slope of graph 1
(C) The vertical intercept of graph 1 divided by the vertical intercept of graph 2
(D) The vertical intercept of graph 2 divided by the vertical intercept of graph 1

Unauthorized copying or reuse of any part of this page is illegal.

GO ON TO THE NEXT PAGE.

张老师欧美留学理科辅导微信：15940415847



11. An electron is moving to the right, as shown in the figure above. It passes through the shaded region, which contains a magnetic field directed into the page. The electron travels along a path that takes it through point *P*. The gravitational force on the electron is negligible. Which of the following is a possible path of the electron?

(A)
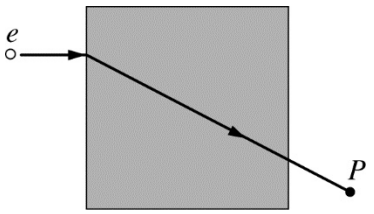

(B)
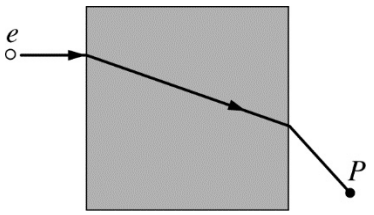

(C)
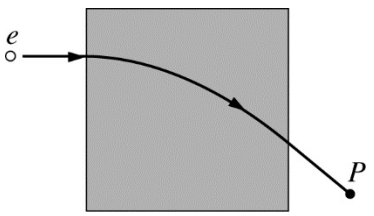

(D)
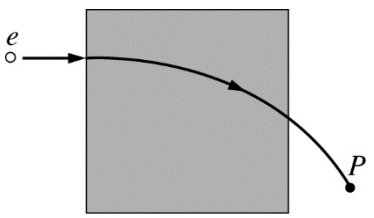

Object Distance from Lens	Orientation of Image	Type of Image	Size of Image Compared to Object
5 cm	Upright	Virtual	Larger
10 cm	Upright	Virtual	Larger
15 cm	Inverted	Real	Larger
25 cm	Inverted	Real	Smaller

12. A student uses a convex lens to create images and collects the data shown above. The focal length of the lens is in which of the following ranges?

(A) 0–5 cm
(B) 5–10 cm
(C) 10–15 cm
(D) 15–25 cm

Unauthorized copying or reuse of any part of this page is illegal.

GO ON TO THE NEXT PAGE.

张老师欧美留学理科辅导微信：15940415847

Questions 13-15 refer to the following material.

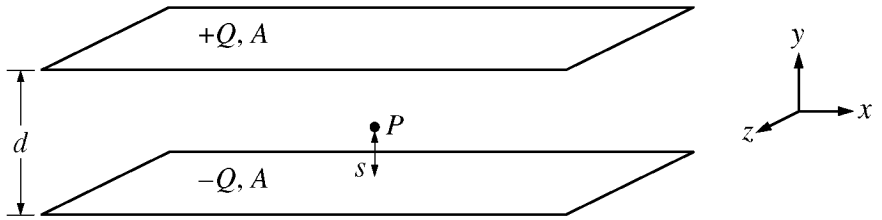

Two conducting plates of area A are separated by a distance d, as shown above. The upper plate has a net charge of $+Q$ and the lower plate has a net charge of $-Q$. Point P is located a distance s above the center of the lower plate and closer to the lower plate than the upper plate. Assume the plate dimensions are very large compared to d and all gravitational forces are negligible.

13. Which of the following indicates the direction of the electric field at point P and the reason it has that direction?

(A) The electric field is in the $+x$ direction because the charges are equal and opposite.
(B) The electric field is in the $-y$ direction because point P is farther from the positively charged plate.
(C) The electric field is in the $-y$ direction because electric fields point away from positive charge and toward negative charge.
(D) The electric field is in the $+y$ direction because electric fields point away from negative charge and toward positive charge.

14. Assume the magnitude of the electric field at point P is 5.0×10^4 N/C. What is the magnitude and direction of the force on an electron at point P due to the electric field?

(A) 3.1×10^{23} N in the same direction as the electric field
(B) 3.1×10^{23} N in the direction opposite to the electric field
(C) 8.0×10^{-15} N in the same direction as the electric field
(D) 8.0×10^{-15} N in the direction opposite to the electric field

15. If the magnitude of the electric field at point P is 5.0×10^4 N/C and the distance between the plates is 0.80 mm, what is the electrical potential difference between the plates?

(A) 40 V
(B) 62.5 V
(C) 4000 V
(D) 6250 V

Unauthorized copying or reuse of any part of this page is illegal.

GO ON TO THE NEXT PAGE.

张老师欧美留学理科辅导微信：15940415847

$$^{238}_{92}\mathrm{U} + X \rightarrow {}^{239}_{92}\mathrm{U}$$

$$^{239}_{92}\mathrm{U} \rightarrow {}^{239}_{93}\mathrm{Np} + Y + \overline{\nu}$$

$$^{239}_{93}\mathrm{Np} \rightarrow {}^{239}_{94}\mathrm{Pu} + Y + \overline{\nu}$$

16. The three reactions shown above, with unidentified particles X and Y, occur in the manufacturing process of plutonium. What particles do X and Y represent?

	X	Y
(A)	$^{1}_{0}\mathrm{n}$	α
(B)	γ	β^{-}
(C)	γ	α
(D)	$^{1}_{0}\mathrm{n}$	β^{-}

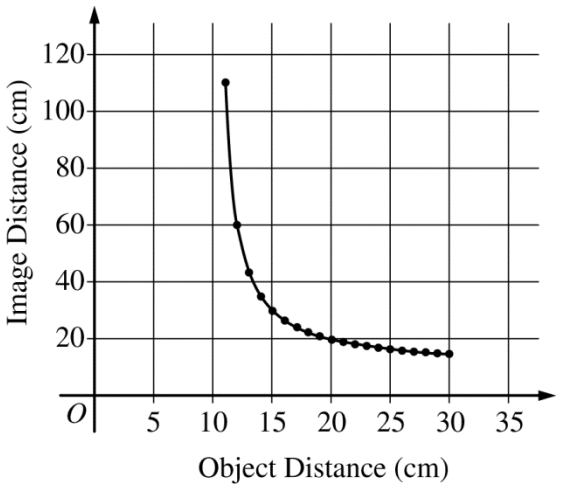

17. Some students collect data to determine the focal length of a concave mirror. Using a small candle as the object, they move a piece of white cardboard until they see a focused image of the candle flame on it. The students measure the distances of the candle and the image from the mirror. A graph of the data is shown above. Which of the following is closest to the focal length of the mirror?

(A) 10 cm
(B) 15 cm
(C) 20 cm
(D) 30 cm

Unauthorized copying or reuse of any part of this page is illegal.

GO ON TO THE NEXT PAGE.

张老师欧美留学理科辅导微信：15940415847

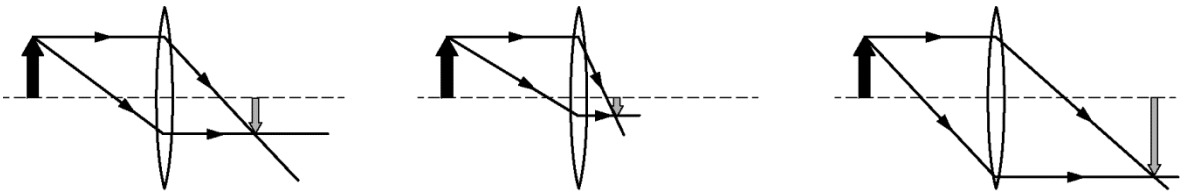

Lens 1 Lens 2 Lens 3

18. A student is comparing three lenses of the same size and shape that are made of different materials. A small object, represented by the thick black arrow, is held on one side of each lens. The ray diagrams above show the formation of the image, represented by the gray arrow, for each lens. Which of the following correctly ranks the index of refraction n of the lenses?

(A) $n_1 > n_2 > n_3$

(B) $n_2 > n_1 > n_3$

(C) $n_3 > n_1 > n_2$

(D) $n_3 > n_2 > n_1$

Unauthorized copying or reuse of any part of this page is illegal.

GO ON TO THE NEXT PAGE.

张老师欧美留学理科辅导微信：15940415847

Questions 19-20 refer to the following material.

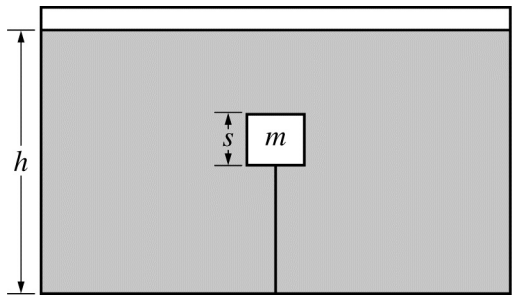

A cube of mass m with sides of length s is completely submerged in a tank of fluid of density ρ and held in place by a string attached to the bottom of the tank, as shown above. The height of the fluid is h, and the string has a nonzero tension F_T.

19. Which of the following indicates how the density of the cube compares with the density of the fluid and provides correct evidence for the comparison?

(A) The fact that the cube is completely submerged is evidence that the density of the cube is greater than the density of the fluid.
(B) The fact that the cube is completely submerged is evidence that the density of the cube is less than the density of the fluid.
(C) The fact that there is tension in the string is evidence that the density of the cube is greater than the density of the fluid.
(D) The fact that there is tension in the string is evidence that the density of the cube is less than the density of the fluid.

20. Which of the following is a correct expression for the density of the cube?

(A) $\left(\rho s^3 g + F_T\right) / s^3 g$
(B) $\left(\rho s^3 g - F_T\right) / s^3 g$
(C) $\left(F_T + mg\right) / s^3 g$
(D) $\left(F_T - mg\right) / s^3 g$

21. About 1×10^{-29} kg of mass is lost when an atom of a certain isotope of plutonium, Pu-239, undergoes a single alpha decay. A small sample is composed of 3×10^{19} Pu-239 atoms. If all the nuclei in the sample undergo alpha decay, the energy released is most nearly

(A) 9×10^{-13} J
(B) 9×10^{-2} J
(C) 3×10^{7} J
(D) 3×10^{21} J

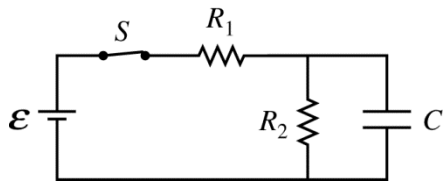

22. The circuit shown above includes a battery, two resistors, and a capacitor with values as labeled. The current through the battery is I. Which of the following is a correct equation for potential differences in the circuit a long time after the switch is closed?

(A) $\mathcal{E} - IR_1 - IR_2 = 0$
(B) $\mathcal{E} + IR_1 + IR_2 = 0$
(C) $\mathcal{E} - IR_1 - IR_2 - C\mathcal{E} = 0$
(D) $\mathcal{E} - IR_1 - IR_2 + C\mathcal{E} = 0$

Unauthorized copying or reuse of any part of this page is illegal.

GO ON TO THE NEXT PAGE.

张老师欧美留学理科辅导微信：15940415847



23. The figure above represents three identical closed containers holding the same number of moles of different gases at the same temperature. From left to right, the gases are in order from smallest molar mass (H_2) to largest molar mass (O_2). Modeling the gases as ideal, which gas, if any, has the greatest internal energy?

(A) H_2
(B) N_2
(C) O_2
(D) All have the same internal energy.

24. A plutonium nucleus of mass M is at rest when it spontaneously emits a high-energy photon of frequency f. After the decay, the photon moves off in one direction and the nucleus recoils with speed v in the opposite direction. The nucleus' mass decreases by an amount Δm. Which of the following equations correctly represents the conservation of energy in the decay?

(A) $(\Delta m)c^2 = \frac{1}{2}(M - \Delta m)v^2 + hf$
(B) $(\Delta m)c^2 = \frac{1}{2}(M - \Delta m)v^2 - hf$
(C) $Mc^2 = \frac{1}{2}(M - \Delta m)v^2 + hf$
(D) $Mc^2 = \frac{1}{2}(M - \Delta m)v^2 - hf$

25. A student wants to increase the temperature of an ideal gas in a cylinder that is initially at room temperature. The cylinder has a movable piston with negligible friction. Which of the following correctly indicates an action the student could take to increase the temperature of the gas, and why the temperature increases?

(A) Pull the piston out rapidly. The gas will expand violently and increase in temperature.
(B) Pull the piston out slowly. The gas will have time to absorb energy from the surroundings by heating as it expands.
(C) Push the piston in rapidly. The temperature of the gas will increase because no energy will be transferred to the surroundings by cooling.
(D) Push the piston in slowly. The gas will have time to absorb energy from the surroundings by heating as it is compressed.

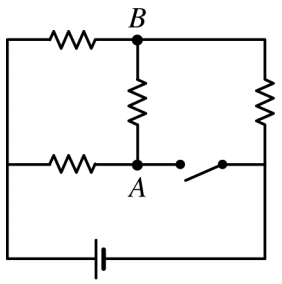

26. The circuit shown above contains four identical resistors connected to a battery and a switch. Which of the following correctly describes the direction of the current, if any, between points A and B when the switch is open and when it is closed?

	Switch Open	Switch Closed
(A)	From B to A	From B to A
(B)	From B to A	From A to B
(C)	From A to B	No current
(D)	From A to B	From B to A

Unauthorized copying or reuse of any part of this page is illegal.

GO ON TO THE NEXT PAGE.

张老师欧美留学理科辅导微信：15940415847

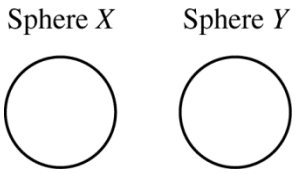

27. Small solid sphere X is made of an insulating material and has negative charge distributed throughout its volume. Small solid sphere Y is made of a conducting material and is also negatively charged. The spheres are initially far apart and are then brought near each other, as shown above. Which of the following cross sections best represents the charge distribution on the two spheres when they are near each other?

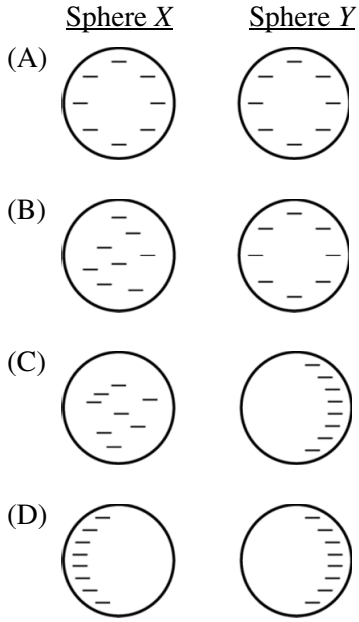

Current Through Bulb (A)	Intensity of Light from the Bulb $\left(\mathrm{W/m^2}\right)$
5	74
10	298
15	675
20	1200
40	4800

28. A student wishes to determine if a particular lightbulb is an ohmic resistor. The student assumes that the intensity of light from the bulb is directly proportional to the power it dissipates. The student measures the light intensity at one location near the bulb and the current through the bulb as the voltage across the bulb is varied. The data are shown above. Based on the data, is the bulb ohmic, and why?

(A) No, because the power is a linear function of the current.
(B) No, because the power is a quadratic function of the current.
(C) Yes, because the power is a linear function of the current.
(D) Yes, because the power is a quadratic function of the current.

Unauthorized copying or reuse of any part of this page is illegal.

GO ON TO THE NEXT PAGE.

张老师欧美留学理科辅导微信：15940415847

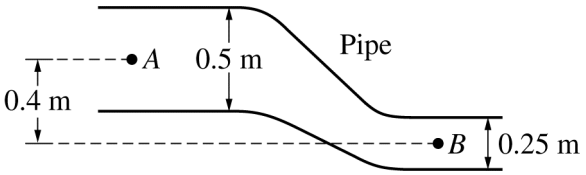

29. An ideal fluid with density $960\ \text{kg/m}^3$ fills the pipe shown in the side view above and flows through it. The pipe has a circular cross section, and the speed of the fluid at point *A* is $0.6\ \text{m/s}$. The difference in the pressure of the fluid at points *A* and *B* is most nearly

(A) 1.2×10^3 Pa
(B) 2.6×10^3 Pa
(C) 3.8×10^3 Pa
(D) 6.4×10^3 Pa

30. Student 1 brings a negatively charged rod with an insulating handle near to but not touching an uncharged metal sphere and finds that the objects attract. She wants the sphere to be repelled by the rod. Student 2, who is uncharged, suggests that this can be accomplished if he touches the sphere. Which of the following indicates whether this will work, and if so, gives a procedure that will cause the repulsion?

(A) Yes, Student 2 could touch the sphere while the rod is held near it, because that would make the sphere negatively charged.
(B) Yes, Student 2 could touch the sphere while the rod is kept far away, because that would make the sphere negatively charged.
(C) Yes, Student 2 could touch the sphere while the rod is kept far away, because that would make the sphere positively charged.
(D) No, there is no way that having Student 2 touch the sphere will work.

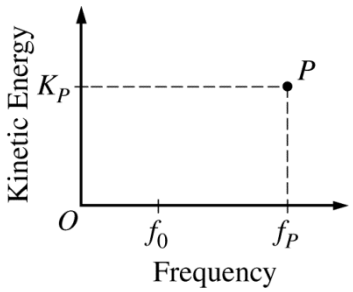

31. When light of frequency f_P is incident on a metal with threshold frequency f_0, electrons are ejected with maximum kinetic energy K_P. This is represented in the graph above by point *P*. How would the location of point *P* on the graph change if the intensity of the same light source were increased?

(A) *P* would not move.
(B) *P* would move vertically up.
(C) *P* would move horizontally to the right.
(D) *P* would move diagonally up and to the right.

32. A student is doing an experiment in which monochromatic light passes through a double slit, creating a pattern of dark and bright lines on a nearby screen. The student has a red light and a green light. The student also has two sets of slits, one with a small separation between the slits and one with a large separation. Which of the following lists the color and slit separation that will create the pattern with the greatest separation between the bright lines?

	Color	Slit Separation
(A)	Green	Large
(B)	Green	Small
(C)	Red	Large
(D)	Red	Small

Unauthorized copying or reuse of any part of this page is illegal.

GO ON TO THE NEXT PAGE.

张老师欧美留学理科辅导微信：15940415847

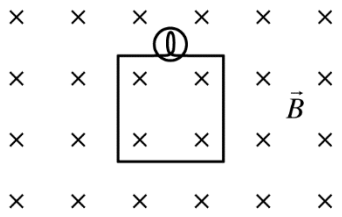

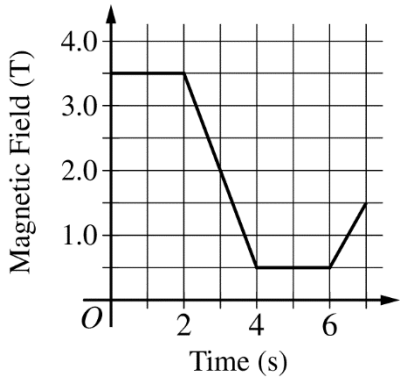

33. A circuit containing only a lightbulb is placed in a uniform magnetic field $\vec{B}$ directed into the page, as shown above on the left. The variation of the magnetic field as a function of time is shown in the graph. During which of the following intervals will the bulb be brightest?

(A) 0-2 s
(B) 2-4 s
(C) 4-6 s
(D) 6-7 s

Unauthorized copying or reuse of any part of this page is illegal.

GO ON TO THE NEXT PAGE.

张老师欧美留学理科辅导微信：15940415847

34. Electronic transitions between the $n = 2$ and $n = 4$ energy levels of a hydrogen atom are associated with the emission or absorption of photons of visible light of frequency f. Which of the following statements about the electronic transition from the $n = 1$ to the $n = 4$ energy level of hydrogen must be true as a consequence of energy conservation?

(A) A photon with a frequency greater than f must be absorbed by the atom.
(B) A photon with a frequency greater than f must be emitted by the atom.
(C) A photon with a frequency smaller than f must be absorbed by the atom.
(D) A photon with a frequency smaller than f must be emitted by the atom.

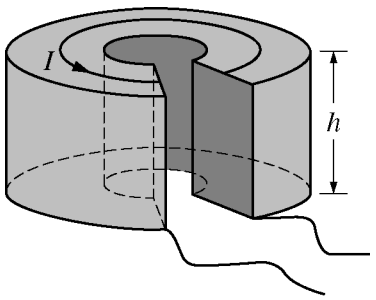

35. A piece of a thick ring of metal with height h and resistance R is connected to a battery, creating a uniform current I throughout the piece of ring, as shown in the figure above. A second piece of a ring has height $2h$ but is otherwise identical to the first piece. The second piece of ring is connected to the battery in the same way as the first piece. What is the resistance of the second piece?

(A) $R/4$
(B) $R/2$
(C) $2R$
(D) $4R$

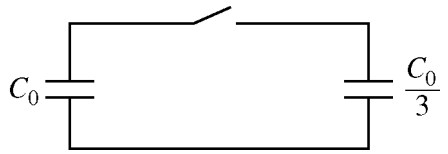

36. A capacitor with capacitance C_0 has a charge Q_0. It is then connected in a circuit with a switch and an initially uncharged capacitor with capacitance $C_0/3$, as shown in the figure above. What are the final charges on the capacitors a long time after the switch is closed?

	Charge on C_0	Charge on $C_0/3$
(A)	$\frac{Q_0}{2}$	$\frac{Q_0}{2}$
(B)	$\frac{Q_0}{3}$	$\frac{2Q_0}{3}$
(C)	$\frac{3Q_0}{4}$	$\frac{Q_0}{4}$
(D)	$\frac{2Q_0}{3}$	$\frac{Q_0}{3}$

Unauthorized copying or reuse of any part of this page is illegal.

GO ON TO THE NEXT PAGE.

Directions: For each of the questions or incomplete statements below, two of the suggested answers will be correct. For each of these questions, you must select both correct choices to earn credit. No partial credit will be earned if only one correct choice is selected. Select the two that are best in each case and then fill in the corresponding circles that begin with number 131 on page 3 of the answer sheet.

131. Conducting rod *A* will be given a positive charge in a procedure that uses some or all of the following steps in an appropriate order.

Step W: Rod *A* is connected to ground.

Step X: Negatively charged rod *B* is brought near, but does not touch, rod *A*.

Step Y: The connection between ground and rod *A* is removed.

Step Z: Rod *B* is moved away.

Which of the following lists sufficient steps in an order that will give rod *A* a positive charge? Select two answers.

(A) W, X, Y
(B) W, X, Z
(C) W, X, Y, Z
(D) W, X, Z, Y

132. Which of the following accurately describe how the kinetic energy of atoms in a sample of monatomic ideal gas changes when the temperature is increased? Select two answers.

(A) The kinetic energy of each individual atom in the gas increases.
(B) The kinetic energy of each individual atom in the gas may increase or decrease.
(C) The average kinetic energy of the whole sample of atoms increases.
(D) The kinetic energy of some individual atoms increases, but the average kinetic energy of the whole sample of atoms does not change.

Unauthorized copying or reuse of any part of this page is illegal.

GO ON TO THE NEXT PAGE.

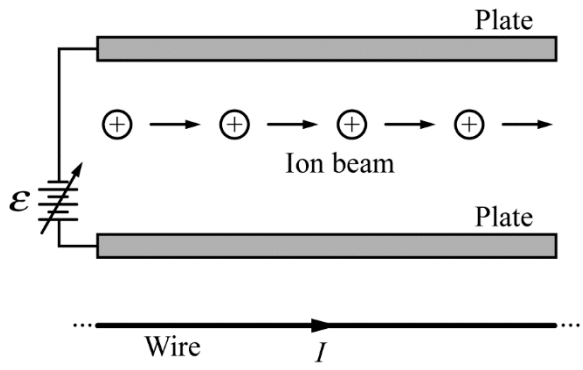

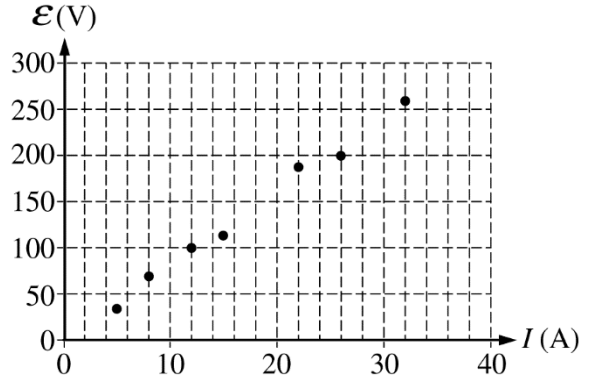

133. A beam of identical positively charged ions moves from left to right between two parallel plates, as shown in the figure on the left above. A wire is located below the plates and parallel to the ion beam. The distance between the plates, the length of the plates, and the distance between the ion beam and the wire are known. A current I in the wire deflects the ion beam from a straight path. The potential difference ε across the plates is then adjusted to return the beam to the straight path. The graph above plots the potential difference across the plates as a function of the current in the wire. Which of the following can be determined from the slope of the graph? Select two answers.

(A) The mass of an ion in the beam if the charge on the ion is known
(B) The average speed of the ions in the beam
(C) The amount of charge on an ion in the beam if the mass of the ion is known
(D) The time an ion spends between the plates

Unauthorized copying or reuse of any part of this page is illegal.

GO ON TO THE NEXT PAGE.

张老师欧美留学理科辅导微信：15940415847

134. One way to model the allowed states of a hydrogen atom is to treat the atom's single electron as a standing wave with a wavelength λ. Which of the following could be the radius of the orbit of the electron in such a model? Select two answers.

(A) $2\lambda/\pi$

(B) $\lambda/4\pi$

(C) $\lambda/2\pi$

(D) $\lambda/2$

Unauthorized copying or reuse of any part of this page is illegal.

GO ON TO THE NEXT PAGE.

张老师欧美留学理科辅导微信：15940415847

END OF SECTION I

IF YOU FINISH BEFORE TIME IS CALLED,
YOU MAY CHECK YOUR WORK ON THIS SECTION.

DO NOT GO ON TO SECTION II UNTIL YOU ARE TOLD TO DO SO.

MAKE SURE YOU HAVE DONE THE FOLLOWING.

- **PLACED YOUR AP NUMBER LABEL ON YOUR ANSWER SHEET**
- **WRITTEN AND GRIDDED YOUR AP NUMBER CORRECTLY ON YOUR ANSWER SHEET**
- **TAKEN THE AP EXAM LABEL FROM THE FRONT OF THIS BOOKLET AND PLACED IT ON YOUR ANSWER SHEET.**

张老师欧美留学理科辅导微信：15940415847

Section II: Free-Response Questions

This is the free-response section of the 2018 AP Exam.
It includes cover material and other administrative instructions
to help familiarize students with the mechanics of the exam.
(Note that future exams may differ in look from the following content.)

张老师欧美留学理科辅导微信：15940415847

AP® Physics 2: Algebra-Based Exam

SECTION II: Free Response

2018

DO NOT OPEN THIS BOOKLET UNTIL YOU ARE TOLD TO DO SO.

At a Glance

Total Time
1 hour and 30 minutes
Number of Questions
4
Percent of Total Score
50%
Writing Instrument
Either pencil or pen with black or dark blue ink
Electronic Device
Calculator allowed
Suggested Time
Approximately 25 minutes each for questions 2 and 3 and 20 minutes each for questions 1 and 4
Weight
Approximate weights:
Questions 2 and 3: 27% each
Questions 1 and 4: 23% each

IMPORTANT Identification Information

PLEASE PRINT WITH PEN:

1. First two letters of your last name ☐☐
   First letter of your first name ☐
2. Date of birth
   ☐☐ Month ☐☐ Day ☐☐☐☐ Year
3. Six-digit school code
   ☐☐☐☐☐☐
4. Unless I check the box below, I grant the College Board the unlimited right to use, reproduce, and publish my free-response materials, both written and oral, for educational research and instructional purposes. My name and the name of my school will not be used in any way in connection with my free-response materials. I understand that I am free to mark "No" with no effect on my score or its reporting.
   No, I do not grant the College Board these rights. ☐

Instructions

The questions for Section II are printed in this booklet. You may use any blank space in the booklet for scratch work, but you must write your answers in the spaces provided for each answer. A table of information and lists of equations that may be helpful are in the booklet. Calculators, rulers, and straightedges may be used in this section.

All final numerical answers should include appropriate units. Credit for your work depends on demonstrating that you know which physical principles would be appropriate to apply in a particular situation. Therefore, you should show your work for each part in the space provided after that part. If you need more space, be sure to clearly indicate where you continue your work. Credit will be awarded only for work that is clearly designated as the solution to a specific part of a question. Credit also depends on the quality of your solutions and explanations, so you should show your work.

Write clearly and legibly. Cross out any errors you make; erased or crossed-out work will not be scored. You may lose credit for incorrect work that is not crossed out.

Manage your time carefully. You may proceed freely from one question to the next. You may review your responses if you finish before the end of the exam is announced.

Form I
Form Code 4OBP4-S

张老师欧美留学理科辅导微信：15940415847

AP® PHYSICS 2 TABLE OF INFORMATION

CONSTANTS AND CONVERSION FACTORS	
Proton mass, $m_p = 1.67 \times 10^{-27}$ kg	Electron charge magnitude, $e = 1.60 \times 10^{-19}$ C
Neutron mass, $m_n = 1.67 \times 10^{-27}$ kg	1 electron volt, $1 \text{ eV} = 1.60 \times 10^{-19}$ J
Electron mass, $m_e = 9.11 \times 10^{-31}$ kg	Speed of light, $c = 3.00 \times 10^{8}$ m/s
Avogadro's number, $N_0 = 6.02 \times 10^{23}$ mol^{-1}	Universal gravitational constant, $G = 6.67 \times 10^{-11}$ m^3/kg·s^2
Universal gas constant, $R = 8.31$ J/(mol·K)	Acceleration due to gravity at Earth's surface, $g = 9.8$ m/s^2
Boltzmann's constant, $k_B = 1.38 \times 10^{-23}$ J/K	

1 unified atomic mass unit,	$1 \text{ u} = 1.66 \times 10^{-27}$ kg $= 931$ MeV/c^2
Planck's constant,	$h = 6.63 \times 10^{-34}$ J·s $= 4.14 \times 10^{-15}$ eV·s
	$hc = 1.99 \times 10^{-25}$ J·m $= 1.24 \times 10^{3}$ eV·nm
Vacuum permittivity,	$\varepsilon_0 = 8.85 \times 10^{-12}$ C^2/N·m^2
Coulomb's law constant,	$k = 1/4\pi\varepsilon_0 = 9.0 \times 10^{9}$ N·m^2/C^2
Vacuum permeability,	$\mu_0 = 4\pi \times 10^{-7}$ (T·m)/A
Magnetic constant,	$k' = \mu_0/4\pi = 1 \times 10^{-7}$ (T·m)/A
1 atmosphere pressure,	$1 \text{ atm} = 1.0 \times 10^{5}$ N/m^2 $= 1.0 \times 10^{5}$ Pa

UNIT SYMBOLS	meter,	m	mole,	mol	watt,	W	farad,	F
	kilogram,	kg	hertz,	Hz	coulomb,	C	tesla,	T
	second,	s	newton,	N	volt,	V	degree Celsius,	°C
	ampere,	A	pascal,	Pa	ohm,	Ω	electron volt,	eV
	kelvin,	K	joule,	J	henry,	H		

PREFIXES		
Factor	Prefix	Symbol
10^{12}	tera	T
10^{9}	giga	G
10^{6}	mega	M
10^{3}	kilo	k
10^{-2}	centi	c
10^{-3}	milli	m
10^{-6}	micro	μ
10^{-9}	nano	n
10^{-12}	pico	p

VALUES OF TRIGONOMETRIC FUNCTIONS FOR COMMON ANGLES							
θ	0°	30°	37°	45°	53°	60°	90°
$\sin\theta$	0	1/2	3/5	$\sqrt{2}/2$	4/5	$\sqrt{3}/2$	1
$\cos\theta$	1	$\sqrt{3}/2$	4/5	$\sqrt{2}/2$	3/5	1/2	0
$\tan\theta$	0	$\sqrt{3}/3$	3/4	1	4/3	$\sqrt{3}$	∞

The following conventions are used in this exam.

I. The frame of reference of any problem is assumed to be inertial unless otherwise stated.
II. In all situations, positive work is defined as work done on a system.
III. The direction of current is conventional current: the direction in which positive charge would drift.
IV. Assume all batteries and meters are ideal unless otherwise stated.
V. Assume edge effects for the electric field of a parallel plate capacitor unless otherwise stated.
VI. For any isolated electrically charged object, the electric potential is defined as zero at infinite distance from the charged object

张老师欧美留学理科辅导微信：15940415847

AP® PHYSICS 2 EQUATIONS

MECHANICS

$v_x = v_{x0} + a_x t$

$x = x_0 + v_{x0}t + \frac{1}{2}a_x t^2$

$v_x^2 = v_{x0}^2 + 2a_x(x - x_0)$

$\vec{a} = \frac{\sum \vec{F}}{m} = \frac{\vec{F}_{net}}{m}$

$|\vec{F}_f| \le \mu |\vec{F}_n|$

$a_c = \frac{v^2}{r}$

$\vec{p} = m\vec{v}$

$\Delta\vec{p} = \vec{F}\,\Delta t$

$K = \frac{1}{2}mv^2$

$\Delta E = W = F_{\|}d = Fd\cos\theta$

$P = \frac{\Delta E}{\Delta t}$

$\theta = \theta_0 + \omega_0 t + \frac{1}{2}\alpha t^2$

$\omega = \omega_0 + \alpha t$

$x = A\cos(\omega t) = A\cos(2\pi f t)$

$x_{cm} = \frac{\sum m_i x_i}{\sum m_i}$

$\vec{\alpha} = \frac{\sum \vec{\tau}}{I} = \frac{\vec{\tau}_{net}}{I}$

$\tau = r_{\perp}F = rF\sin\theta$

$L = I\omega$

$\Delta L = \tau\,\Delta t$

$K = \frac{1}{2}I\omega^2$

$|\vec{F}_s| = k|\vec{x}|$

a = acceleration
A = amplitude
d = distance
E = energy
F = force
f = frequency
I = rotational inertia
K = kinetic energy
k = spring constant
L = angular momentum
ℓ = length
m = mass
P = power
p = momentum
r = radius or separation
T = period
t = time
U = potential energy
v = speed
W = work done on a system
x = position
y = height
α = angular acceleration
μ = coefficient of friction
θ = angle
τ = torque
ω = angular speed

$U_s = \frac{1}{2}kx^2$

$\Delta U_g = mg\,\Delta y$

$T = \frac{2\pi}{\omega} = \frac{1}{f}$

$T_s = 2\pi\sqrt{\frac{m}{k}}$

$T_p = 2\pi\sqrt{\frac{\ell}{g}}$

$|\vec{F}_g| = G\frac{m_1 m_2}{r^2}$

$\vec{g} = \frac{\vec{F}_g}{m}$

$U_G = -\frac{Gm_1 m_2}{r}$

ELECTRICITY AND MAGNETISM

$|\vec{F}_E| = \frac{1}{4\pi\varepsilon_0}\frac{|q_1 q_2|}{r^2}$

$\vec{E} = \frac{\vec{F}_E}{q}$

$|\vec{E}| = \frac{1}{4\pi\varepsilon_0}\frac{|q|}{r^2}$

$\Delta U_E = q\Delta V$

$V = \frac{1}{4\pi\varepsilon_0}\frac{q}{r}$

$|\vec{E}| = \left|\frac{\Delta V}{\Delta r}\right|$

$\Delta V = \frac{Q}{C}$

$C = \kappa\varepsilon_0\frac{A}{d}$

$E = \frac{Q}{\varepsilon_0 A}$

$U_C = \frac{1}{2}Q\Delta V = \frac{1}{2}C(\Delta V)^2$

$I = \frac{\Delta Q}{\Delta t}$

$R = \frac{\rho\ell}{A}$

$P = I\,\Delta V$

$I = \frac{\Delta V}{R}$

$R_s = \sum_i R_i$

$\frac{1}{R_p} = \sum_i \frac{1}{R_i}$

$C_p = \sum_i C_i$

$\frac{1}{C_s} = \sum_i \frac{1}{C_i}$

$B = \frac{\mu_0}{2\pi}\frac{I}{r}$

A = area
B = magnetic field
C = capacitance
d = distance
E = electric field
$\mathcal{E}$ = emf
F = force
I = current
ℓ = length
P = power
Q = charge
q = point charge
R = resistance
r = separation
t = time
U = potential (stored) energy
V = electric potential
v = speed
κ = dielectric constant
ρ = resistivity
θ = angle
Φ = flux

$\vec{F}_M = q\vec{v}\times\vec{B}$

$|\vec{F}_M| = |q\vec{v}||\sin\theta||\vec{B}|$

$\vec{F}_M = I\vec{\ell}\times\vec{B}$

$|\vec{F}_M| = |I\vec{\ell}||\sin\theta||\vec{B}|$

$\Phi_B = \vec{B}\cdot\vec{A}$

$\Phi_B = |\vec{B}|\cos\theta|\vec{A}|$

$\mathcal{E} = -\frac{\Delta\Phi_B}{\Delta t}$

$\mathcal{E} = B\ell v$

张老师欧美留学理科辅导微信：15940415847

AP® PHYSICS 2 EQUATIONS

FLUID MECHANICS AND THERMAL PHYSICS

$\rho = \frac{m}{V}$

$P = \frac{F}{A}$

$P = P_0 + \rho g h$

$F_b = \rho V g$

$A_1 v_1 = A_2 v_2$

$P_1 + \rho g y_1 + \frac{1}{2}\rho {v_1}^2 = P_2 + \rho g y_2 + \frac{1}{2}\rho {v_2}^2$

$\frac{Q}{\Delta t} = \frac{kA\,\Delta T}{L}$

$PV = nRT = Nk_BT$

$K = \frac{3}{2}k_BT$

$W = -P\Delta V$

$\Delta U = Q + W$

A = area
F = force
h = depth
k = thermal conductivity
K = kinetic energy
L = thickness
m = mass
n = number of moles
N = number of molecules
P = pressure
Q = energy transferred to a system by heating
T = temperature
t = time
U = internal energy
V = volume
v = speed
W = work done on a system
y = height
ρ = density

MODERN PHYSICS

$E = hf$

$K_{\max} = hf - \phi$

$\lambda = \frac{h}{p}$

$E = mc^2$

E = energy
f = frequency
K = kinetic energy
m = mass
p = momentum
λ = wavelength
ϕ = work function

WAVES AND OPTICS

$\lambda = \frac{v}{f}$

$n = \frac{c}{v}$

$n_1 \sin\theta_1 = n_2 \sin\theta_2$

$\frac{1}{s_i} + \frac{1}{s_o} = \frac{1}{f}$

$|M| = \left|\frac{h_i}{h_o}\right| = \left|\frac{s_i}{s_o}\right|$

$\Delta L = m\lambda$

$d\sin\theta = m\lambda$

d = separation
f = frequency or focal length
h = height
L = distance
M = magnification
m = an integer
n = index of refraction
s = distance
v = speed
λ = wavelength
θ = angle

GEOMETRY AND TRIGONOMETRY

Rectangle
$A = bh$

Triangle
$A = \frac{1}{2}bh$

Circle
$A = \pi r^2$
$C = 2\pi r$

Rectangular solid
$V = \ell w h$

Cylinder
$V = \pi r^2 \ell$
$S = 2\pi r\ell + 2\pi r^2$

Sphere
$V = \frac{4}{3}\pi r^3$
$S = 4\pi r^2$

A = area
C = circumference
V = volume
S = surface area
b = base
h = height
ℓ = length
w = width
r = radius

Right triangle
$c^2 = a^2 + b^2$
$\sin\theta = \frac{a}{c}$
$\cos\theta = \frac{b}{c}$
$\tan\theta = \frac{a}{b}$

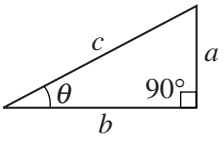

张老师欧美留学理科辅导微信：15940415847

PHYSICS 2

Section II

Time—1 hour and 30 minutes

4 Questions

Directions: Questions 1 and 4 are short free-response questions that require about 20 minutes each to answer and are worth 10 points each. Questions 2 and 3 are long free-response questions that require about 25 minutes each to answer and are worth 12 points each. Show your work for each part in the space provided after that part.

1. (10 points, suggested time 20 minutes)

   A student is performing some lab experiments with batteries, ohmic resistors, capacitors, and some identical ohmic lightbulbs.

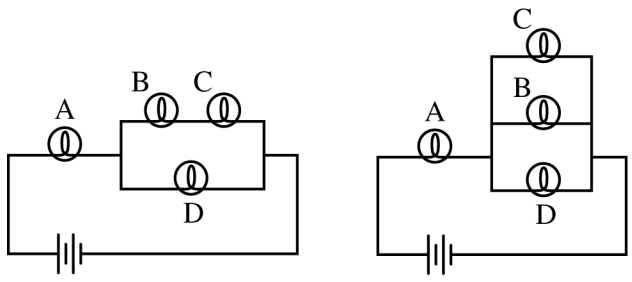

Circuit 1 Circuit 2

   (a) The student first connects four lightbulbs and an ideal battery as shown above in circuit 1 and observes the brightness of each lightbulb. The student then moves lightbulb C to obtain circuit 2. In a coherent, paragraph-length response, describe how the brightnesses of lightbulbs A and D in circuit 2 compare to their brightnesses in circuit 1. Support your claims with appropriate physics principles.

Unauthorized copying or reuse of any part of this page is illegal.

张老师欧美留学理科辅导微信：15940415847

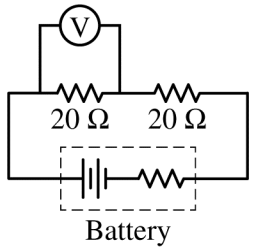

(b) The student thinks that one of the available batteries has a nonnegligible internal resistance. The student measures the potential difference across the battery as 9 V when it is not connected to any other circuit elements. The student then connects the circuit shown above, where the battery is represented by the circuit elements in the dashed box. The voltmeter indicates that the potential difference across one resistor is 4 V. Calculate the internal resistance of the battery.

(c) One of the lightbulbs is now connected with an ideal battery, an open switch, a resistor R and an initially uncharged capacitor C, as shown below. The resistance of the lightbulb and the resistor are about the same. The switch is then closed and left closed for a long time. Describe how, if at all, the brightness of the lightbulb changes during the time the switch remains closed, and explain why.

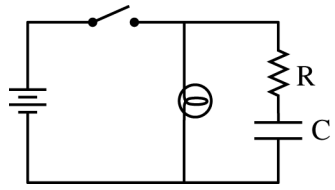

Unauthorized copying or reuse of any part of this page is illegal.

张老师欧美留学理科辅导微信：15940415847

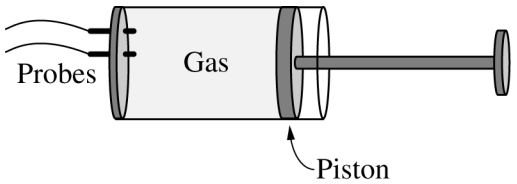

2. (12 points, suggested time 25 minutes)

A cylinder with a movable piston contains a sample of ideal gas. A temperature probe and a pressure probe are inserted into the cylinder, as shown above. The sample of gas is taken through a three-step cycle, *ABCA*.

- In process *AB*, the volume is decreased to $1/4$ its original value while constant pressure is maintained.
- In process *BC*, the gas expands back to its original volume isothermally.
- In process *CA*, the gas returns to its original state without any work being done on or by the gas.

(a)

i. On the axes below, draw a graph of pressure *P* as a function of volume *V* for the three-step process *ABCA*, labeling states *B* and *C*. The pressure and volume of state *A* are P_A and V_A, respectively. Label the axes with the values of pressure and volume for states *B* and *C* in terms of P_A and V_A.

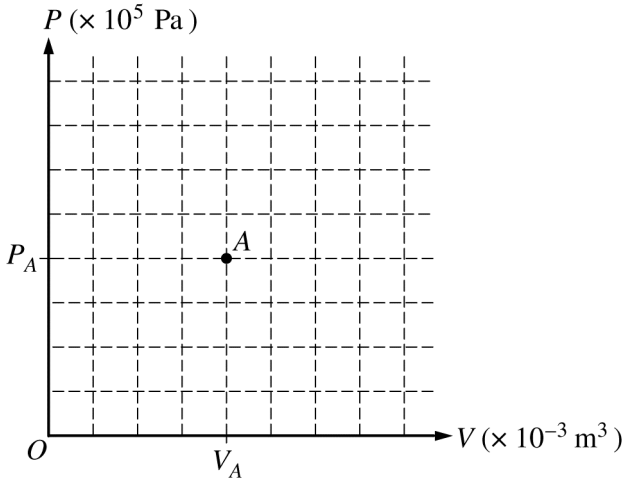

ii. For process *BC*, is energy added to the gas by heating or removed from the gas by cooling? Support your claim using physics principles.

Unauthorized copying or reuse of any part of this page is illegal.

GO ON TO THE NEXT PAGE.

张老师欧美留学理科辅导微信：15940415847

(b) For process *CA*, is the net flow of energy into the gas or out of the gas? Explain your reasoning using physics principles. Describe one method by which this flow of energy could be accomplished in the laboratory.

(c) Curves 1 and 2 below show the distributions of particle speeds when the sample of gas is in two of the states, with curve 1 a state that occurs before curve 2 as the gas goes through the cycle. Which states correspond to curve 1 and 2? Support your claim using physics principles.

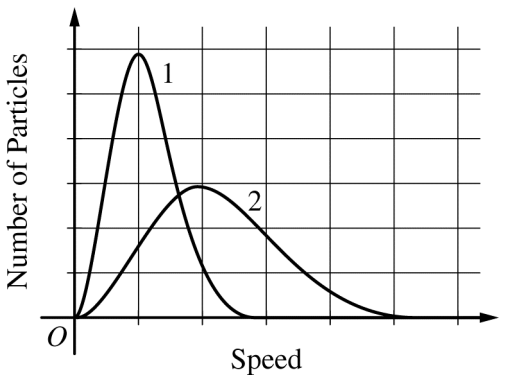

Unauthorized copying or reuse of any part of this page is illegal.

张老师欧美留学理科辅导微信：15940415847

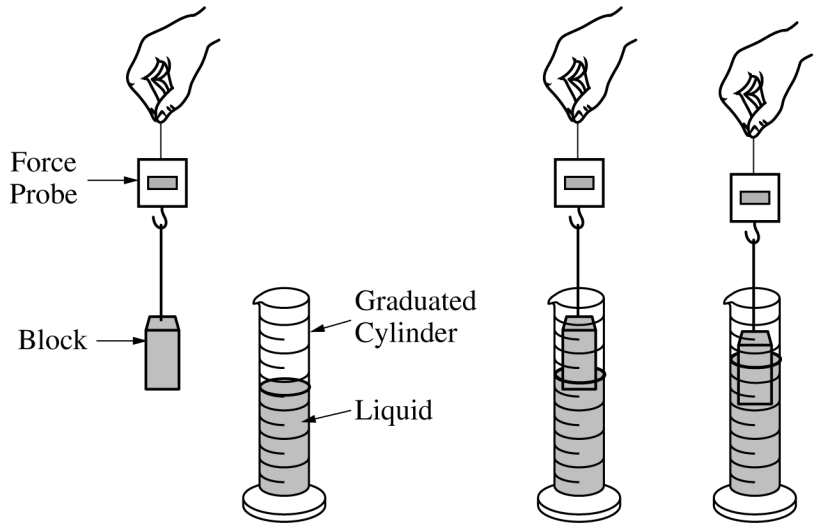

3. (12 points, suggested time 25 minutes)

Two groups of students are given samples of the same unknown liquid and are asked to identify the liquid. The first group decides to do this by determining its density ρ_L. The students pour a volume V_i of the liquid into a graduated cylinder. They then hang a long solid block of mass m_b from a force probe and lower the block partially into the liquid, as shown above. The students record the reading on the force probe and the volume reading V_f on the graduated cylinder for various amounts of the block lowered into the liquid.

(a)

i. On the square below, which represents the block, draw and label the forces (not components) that are exerted on the block when it is stationary and partially submerged in the liquid. Each force must be represented by a distinct arrow starting on, and pointing away from, the square.

ii. Derive an equation for the force probe reading F_p in terms of ρ_L, m_b, V_i, V_f, and physical constants, as appropriate.

Unauthorized copying or reuse of any part of this page is illegal.

GO ON TO THE NEXT PAGE.

张老师欧美留学理科辅导微信：15940415847

The data the students collected and the graph they plotted are shown below. The initial volume V_i of liquid in the cylinder is 1.00×10^{-4} m^3.

Volume Reading V_f $\left(\times 10^{-4}\ \text{m}^3\right)$	1.04	1.06	1.08	1.1	1.12	1.15
Volume Displaced ΔV $\left(\times 10^{-4}\ \text{m}^3\right)$	0.04	0.06	0.08	0.10	0.12	0.15
Force Probe Reading (N)	0.26	0.20	0.17	0.15	0.12	0.04

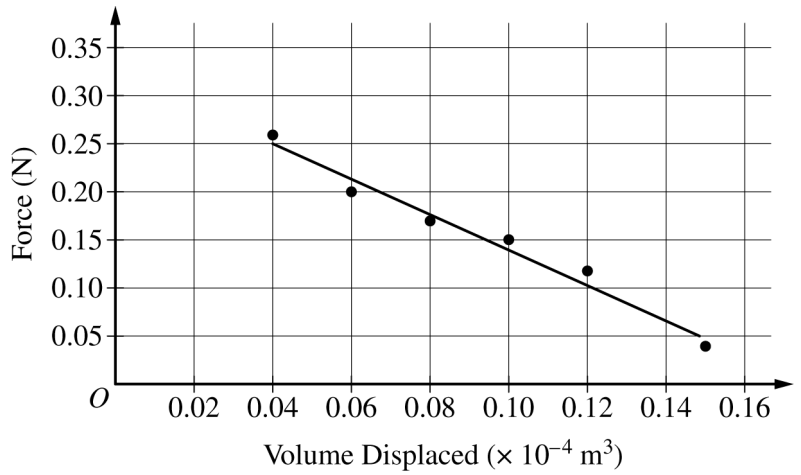

(b)

i. State the physical meaning of the slope of the line and its intercept with the vertical axis.

ii. Use the graph to calculate the density of the liquid.

Question 3 continues on the next page.

Unauthorized copying or reuse of any part of this page is illegal.

张老师欧美留学理科辅导微信：15940415847

The students in the second group decide to determine the index of refraction of the liquid. They have a laser pointer and a transparent, thin-walled rectangular container to hold the liquid. They also have access to common laboratory equipment.

(c) Describe an experimental procedure this group could use to determine the index of refraction of the unknown liquid. In your description include the measurements to be taken. Also include the corresponding equipment needed. Sketch a diagram showing the experimental setup with labels corresponding to the measurements you indicated. Describe how the measurements will be used to calculate the index of refraction of the liquid.

Write procedure here.

Draw labeled diagram here.

Unauthorized copying or reuse of any part of this page is illegal.

张老师欧美留学理科辅导微信：15940415847

THIS PAGE MAY BE USED FOR SCRATCH WORK.

GO ON TO THE NEXT PAGE.

张老师欧美留学理科辅导微信：15940415847

4. (10 points, suggested time 20 minutes)

The allowed energy levels of a hypothetical atom have principal quantum numbers n = 1, 2, 3, and 4 and energies of -8 eV, -5 eV, -2 eV, and -1 eV.

(a)

i. Draw the energy-level diagram for the atom. Label each level with the appropriate energy and principal quantum number.

ii. Calculate the frequency of a photon that will excite the atom from its ground state to the $n = 3$ state.

iii. A photon of wavelength 124 nm is incident on the atom and causes an electron in the ground state to be ejected from the atom. Neglecting relativistic effects, calculate the speed of the electron.

Unauthorized copying or reuse of any part of this page is illegal.

张老师欧美留学理科辅导微信：15940415847

(b) The ejected electron then enters a region of space that contains a constant, uniform magnetic field directed into the plane of the page. The electron is moving to the left in the plane of the page when it enters the field.

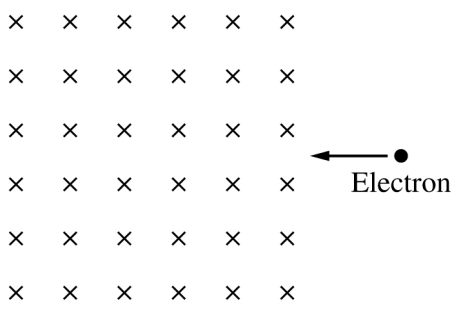

i. On the figure above, draw a possible path for the electron as it travels through the region of the magnetic field. Describe what happens to the speed of the electron as it passes through the field, and explain why this happens.

ii. To make the electron travel in a straight line to the left through the magnetic field, an electric field can be applied in the region. What is the direction of the required electric field? Justify your choice based on physics principles.

Unauthorized copying or reuse of any part of this page is illegal.

张老师欧美留学理科辅导微信：15940415847

THIS PAGE MAY BE USED FOR SCRATCH WORK.

STOP

END OF EXAM

**IF YOU FINISH BEFORE TIME IS CALLED,
YOU MAY CHECK YOUR WORK ON THIS SECTION.**

THE FOLLOWING INSTRUCTIONS APPLY TO THE COVERS OF THE SECTION II BOOKLET.

- **MAKE SURE YOU HAVE COMPLETED THE IDENTIFICATION INFORMATION AS REQUESTED ON THE FRONT AND BACK COVERS OF THE SECTION II BOOKLET.**
- **CHECK TO SEE THAT YOUR AP NUMBER LABEL APPEARS IN THE BOX ON THE FRONT COVER.**
- **MAKE SURE YOU HAVE USED THE SAME SET OF AP NUMBER LABELS ON ALL AP EXAMS YOU HAVE TAKEN THIS YEAR.**